Dividing with a Numberline

Name:

Use the numberline to solve each problem.

1) 12÷3=

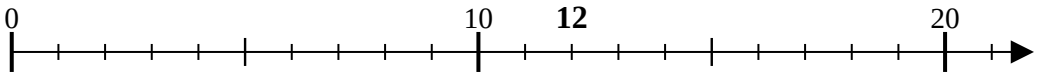

2) 45÷9=

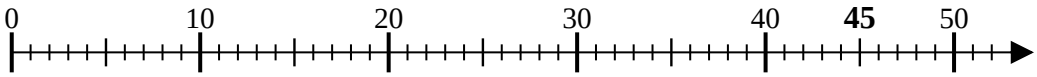

3) 40÷8=

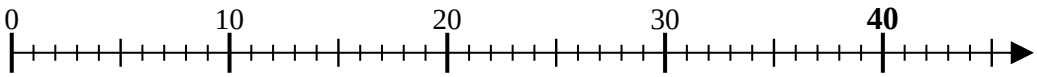

4) 36÷9=

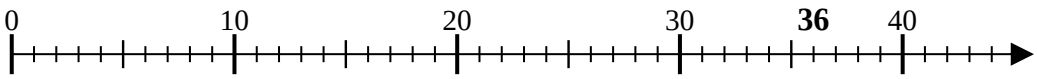

5) 8÷2=

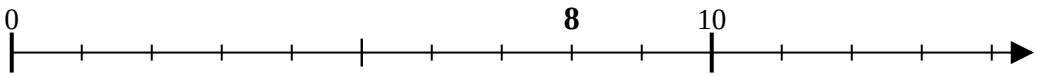

6) 50÷10=

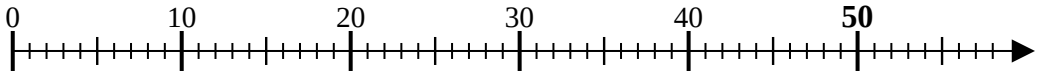

7) 15÷3=

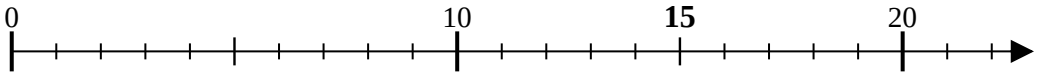

8) 40÷10=

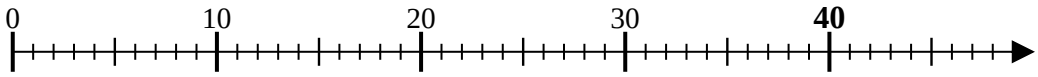

9) 6÷3=

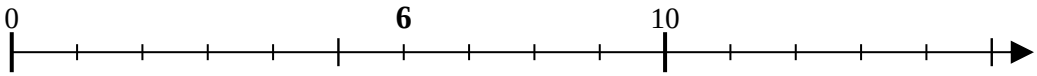

10) 10÷5=

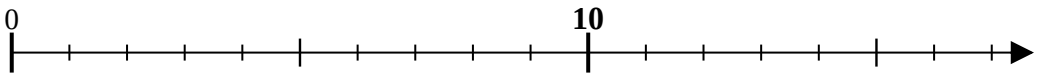

11) 25÷5=

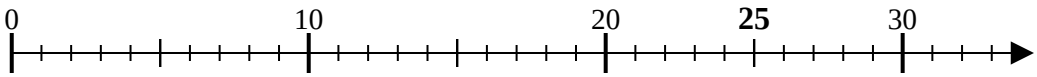

Answers

1. _____
2. _____
3. _____
4. _____
5. _____
6. _____
7. _____
8. _____
9. _____
10. _____
11. _____

1-10	91	82	73	64	55	45	36	27	18	9
11	0									

Dividing with a Numberline

Name: **Answer Key**

Use the numberline to solve each problem.

1) 12÷3=

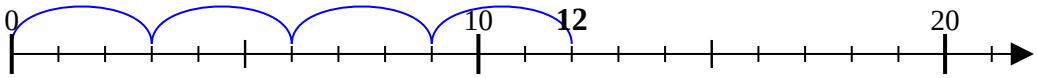

2) 45÷9=

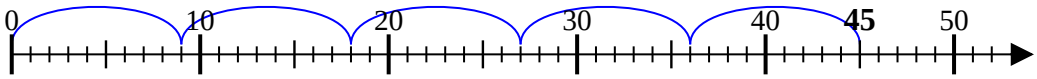

3) 40÷8=

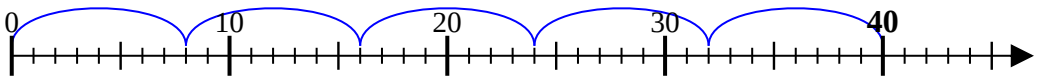

4) 36÷9=

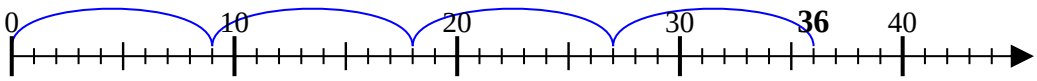

5) 8÷2=

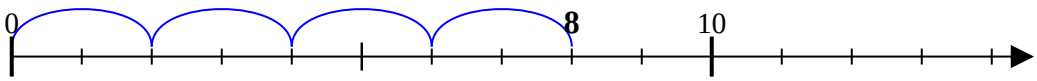

6) 50÷10=

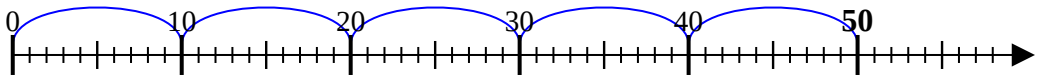

7) 15÷3=

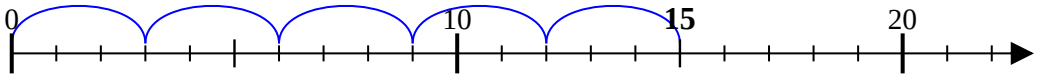

8) 40÷10=

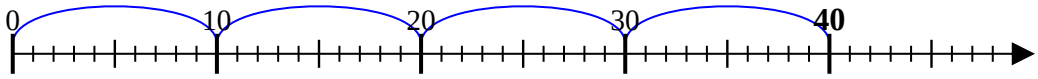

9) 6÷3=

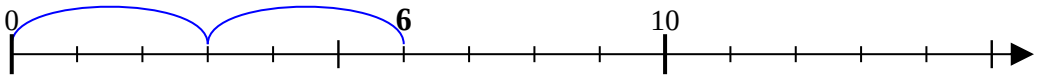

10) 10÷5=

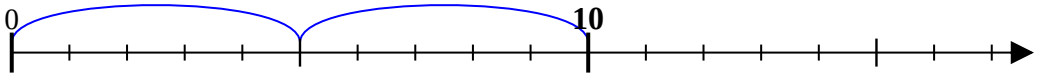

11) 25÷5=

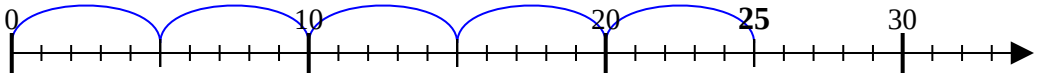

Answers

1. 4
2. 5
3. 5
4. 4
5. 4
6. 5
7. 5
8. 4
9. 2
10. 2
11. 5

1-10	91	82	73	64	55	45	36	27	18	9
11	0									